1.- Identificar elementos da placa dum IBM PC



2.- Identificar elementos da placa dum Pentium I



3.- Identificar elementos desta placa



4.- Identificar elementos desta placa